1 Exercises

1.1 Exercise

What fraction is represented by the figure?

1. 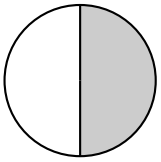 ___

2. 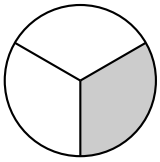 ___

3. 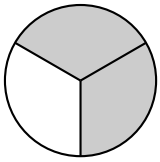 ___

4. 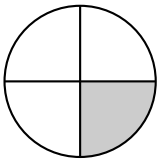 ___

5. 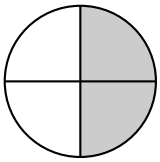 ___

6. 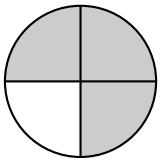 ___

7. 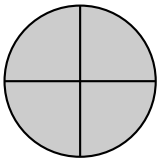 ___

8. 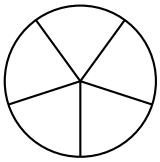 ___

9. 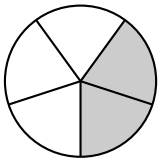 ___

10. 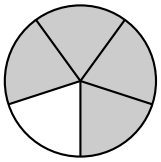 ___

11. 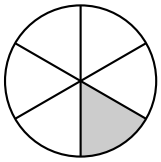 ___

12. 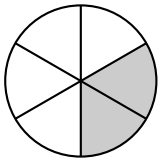 ___

13. 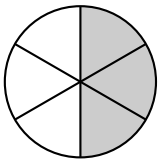 ___

14. 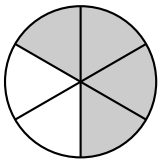 ___

15. 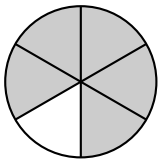 ___

16. 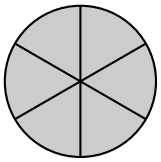 ___

17. 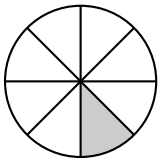 ___

18. 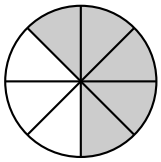 ___

19. 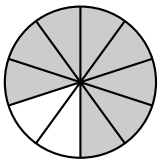 ___

2 Answers

2.1 Exercise

What fraction is represented by the figure?

1. 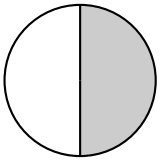 $\frac{1}{2}$

2. 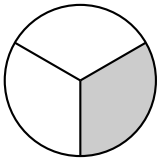 $\frac{1}{3}$

3. 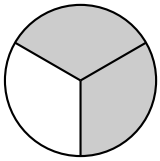 $\frac{2}{3}$

4. 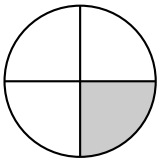 $\frac{1}{4}$

5. 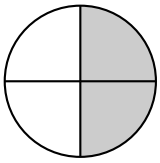 $\frac{2}{4}$

6. 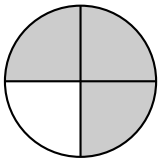 $\frac{3}{4}$

7. 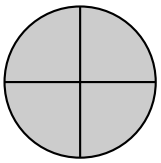 $\frac{4}{4}$

8. 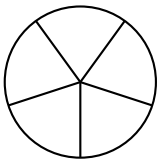 $\frac{0}{5}$

9. 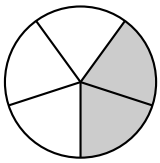 $\frac{2}{5}$

10. 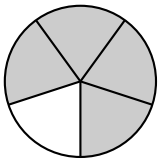 $\frac{4}{5}$

11. 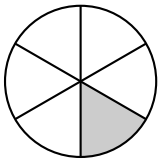 $\frac{1}{6}$

12. 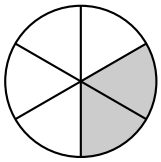 $\frac{2}{6}$

13. 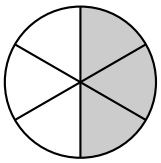 $\frac{3}{6}$

14. 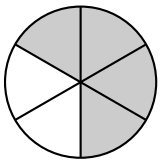 $\frac{4}{6}$

15. 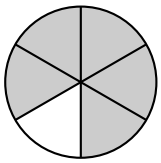 $\frac{5}{6}$

16. 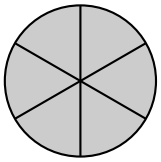 $\frac{6}{6}$

17. 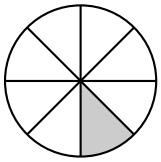 $\frac{1}{8}$

18. 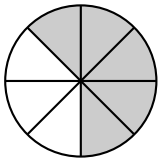 $\frac{5}{8}$

19. 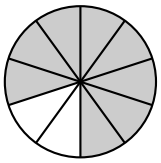 $\frac{8}{10}$