1 Exercises

1.1 Exercise

What fraction is represented by the figure?

1.  ___

2. ___

3.  ___

4. ___

5. ___

6. ___

7. ___

8. ___

9. ___

10. ___

11. ___

12. ___

13. ___

14. ___

15. ___

16. ___

17. ___

18. ___

19. 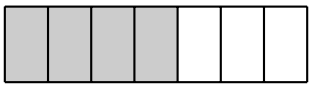 ___

20. ___

21. 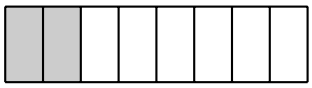 ___

2 Answers

2.1 Exercise

What fraction is represented by the figure?

1.  $\frac{0}{1}$

2. $\frac{1}{2}$

3.  $\frac{1}{3}$

4. $\frac{2}{3}$

5. $\frac{3}{3}$

6. $\frac{0}{4}$

7. $\frac{1}{4}$

8. $\frac{2}{4}$

9. $\frac{3}{4}$

10. $\frac{2}{5}$

11. $\frac{3}{5}$

12. $\frac{4}{5}$

13. $\frac{5}{5}$

14. 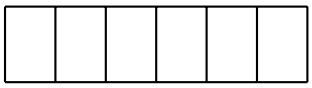 $\frac{0}{6}$

15. 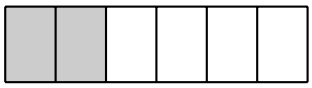 $\frac{2}{6}$

16. $\frac{3}{6}$

17. $\frac{4}{6}$

18. $\frac{6}{6}$

19. $\frac{4}{7}$

20. $\frac{7}{7}$

21. 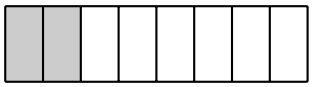 $\frac{2}{8}$