1 Exercises

1.1 Exercise

What fraction is represented by the figure?

1. 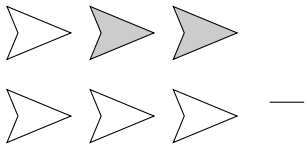 ___

2. 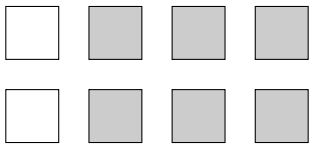 ___

3. 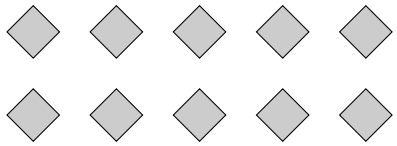 ___

4.  ___

5.  ___

6.  ___

7.  ____

8. 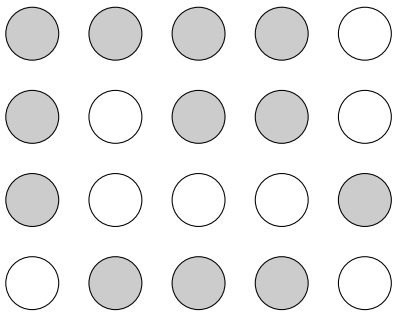 ____

9.  ____

2 Answers

2.1 Exercise

What fraction is represented by the figure?

1. 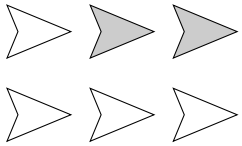 $\frac{2}{6}$

2. 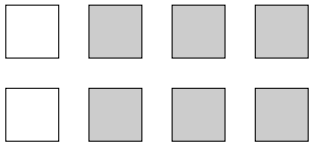 $\frac{6}{8}$

3.

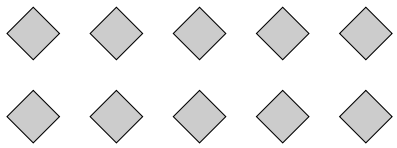

$\frac{10}{10}$

4.



$\frac{6}{12}$

5.



$\frac{1}{16}$

6.



$\frac{6}{20}$

7.



$\frac{11}{20}$

8.

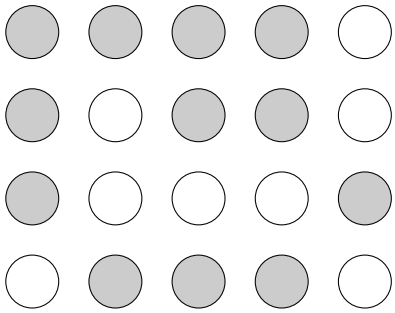

$\frac{12}{20}$

9.



$\frac{20}{20}$